YEAR 3 MATHS · MISSION 6

Perimeter

Score / 8

Name _____ Date _____

Find the perimeter

Add all the sides. (Shapes are not drawn to scale.)

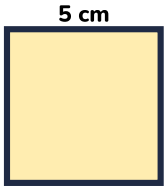

1 Perimeter = ☐ cm

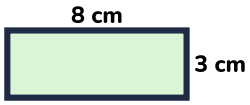

2 Perimeter = ☐ cm

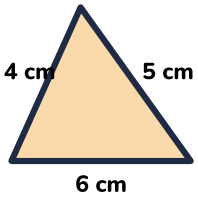

3 Perimeter = ☐ cm

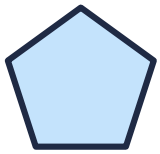

4 Perimeter = ☐ cm

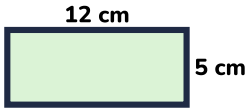

5 Perimeter = ☐ cm

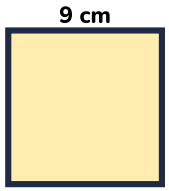

6 Perimeter = ☐ cm

Word problems

7 A square has sides of 7 cm. What is its perimeter? ☐

8 A rectangle is 10 cm long and 4 cm wide. What is its perimeter? ☐

YEAR 3 MATHS · MISSION 6

Perimeter ANSWERS

Score / 8

Name _____ Date _____

Find the perimeter

Add all the sides. (Shapes are not drawn to scale.)

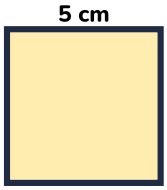

1 Perimeter = 20 cm

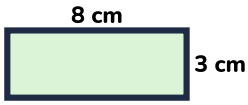

2 Perimeter = 22 cm

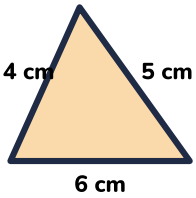

3 Perimeter = 15 cm

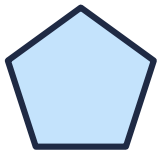

4 Perimeter = 20 cm

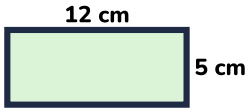

5 Perimeter = 34 cm

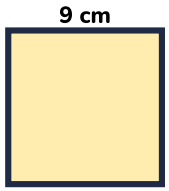

6 Perimeter = 36 cm

Word problems

7 A square has sides of 7 cm. What is its perimeter? 28 cm

8 A rectangle is 10 cm long and 4 cm wide. What is its perimeter? 28 cm