YEAR 1 MATHS · MISSION 5

Halves and Quarters

Score / 14

Name _____ Date _____

Shade the shape Colour one equal part.

1 Shade a half



2 Shade a quarter



3 Shade a half



4 Shade a quarter



5 Shade a half



6 Shade a quarter



Find half Share into 2 equal groups.

7  Half of 8 = ☐

8  Half of 4 = ☐

9  Half of 6 = ☐

10  Half of 4 = ☐

Find a quarter Share into 4 equal groups.

11 A quarter of 8 = ☐

12 A quarter of 12 = ☐

13 A quarter of 4 = ☐

14 A quarter of 20 = ☐

YEAR 1 MATHS · MISSION 5

Halves and Quarters

ANSWERS

Score / 14

Name _____ Date _____

Shade the shape

Colour one equal part.

1. Shade a half

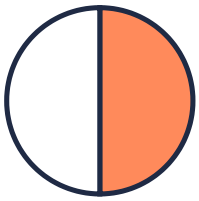

2. Shade a quarter



3. Shade a half



4. Shade a quarter



5. Shade a half



6. Shade a quarter



Find half

Share into 2 equal groups.

7.  Half of 8 = 4

8.  Half of 4 = 2

9.  Half of 6 = 3

10.  Half of 4 = 2

Find a quarter

Share into 4 equal groups.

11. A quarter of 8 = 2

12. A quarter of 12 = 3

13. A quarter of 4 = 1

14. A quarter of 20 = 5