Name _____

Multiplication Arrays

GRADE 2-3 Count the rows and the dots in each row. Write the multiplication sentence.



_____ × _____ = _____



_____ × _____ = _____



_____ × _____ = _____



_____ × _____ = _____



_____ × _____ = _____



_____ × _____ = _____



_____ × _____ = _____



_____ × _____ = _____

Multiplication Arrays

ANSWERS GRADE 2-3 Count the rows and the dots in each row. Write the multiplication sentence.



2 × 5 = 10



2 × 5 = 10



3 × 2 = 6



3 × 2 = 6



3 × 3 = 9



3 × 2 = 6



2 × 3 = 6



3 × 6 = 18